School Name: _____

SECOND ASSESSMENT (SA-2)

SESSION: 2026·27

Class: 5 **Subject: Mathematics** **Date:** _____

Name: _____ **Roll No.:** _____

Solve all questions. The teacher may read the instructions aloud.

1. Mark the angle formed at the corner of the table.

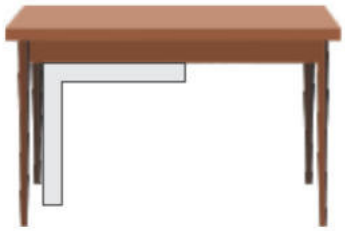

[ ] Right Angle (90°) [ ] Obtuse Angle

2. Look at the picture and fill in the blanks.



The number circled on the note is ..... (62005 / 500)

3. Write the place value and number.

1. The value of 4 in 45,678 = ... (40000 / 400)

2. The value of 3 in 83,215 = ... (3000 / 300)

3. The face value of 9 in 72,941 = ... (9 / 900)

4. 50000 + 4000 + 300 + 20 + 6 = ... (54326)

5. After adding 1 to 99,999 = ... (100000 / 99990)

4. Match the picture with its correct angle.



Acute Angle (less than 90°)



Obtuse Angle (greater than 90°)

5. Solve as directed and fill in the blanks.

1. A right angle measures = ... (90° / 180°)

2. A straight angle measures = ... (180° / 90°)

3. An angle smaller than 90° is ..... (acute / obtuse)

4. The base of the binary system is ..... (2 / 10)

5. Number of zeros in 1 lakh = ... (5 / 4)

6. One million equals ..... lakhs (10 / 100)

6. Draw the hands on the clocks to show the given angles.

Right Angle (90°)	Obtuse Angle (>90°)	Acute Angle (<90°)
		

7. Choose the correct option and tick the box.

Largest 5-digit number:

☐ 99,999 ☐ 10,000

Smallest 5-digit number:

☐ 10,000 ☐ 99,999

Angle-measuring tool:

☐ Protractor ☐ Compass

45° angle:

☐ Acute angle ☐ Right angle

8. Look at the list and tick the price of the bottle gourd.



☐ Rs. 12 (8 + 4) ☐ Rs. 20

9. Write the numbers in words or figures.

(i) Write 52,585 in words:

(ii) Write 85,006 in words:

(iii) Write 'Forty thousand seven hundred' in figures:

(iv) Write 'Ninety thousand eight hundred five' in figures:

10. Colour the figures according to the fraction.

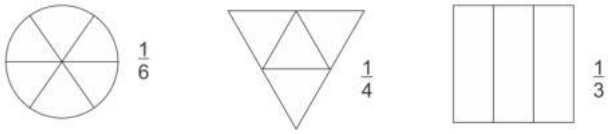

11. Identify the number pattern and continue.

(i) 26230, 26232, 26234, ...

(ii) 28000, 29000, 30000, ...

(iii) 62200, 62300, 62400, ...

(iv) 11×11 = 121, 111×111 = ...

12. Solve the questions from the textbook.

(i) There are 1145 camels and 1425 horses at a fair. How many in all?

(ii) Find the sum of 5369 goats and 2778 sheep:

(iii) How many remain when 43,100 is subtracted from 85,200?

(iv) One bus ticket costs Rs. 665. What is the cost of 15 tickets?

.....

Teacher's Remarks: ..... Signature: .....