School Name: .....

SECOND ASSESSMENT (SA-2) | SESSION: 2026-27

Class: 4 Subject: Mathematics Date: .....

Name: ..... Roll No.: .....

Solve all questions. The teacher may read the instructions aloud.

1. Look at the abacus and tick (✓) the correct number.

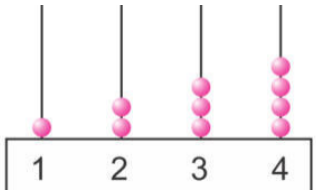

Thousands Hundreds Tens Ones

☐ 1234 (One thousand two hundred thirty-four)

☐ 4321

2. Look at the picture and fill in the blank.



Tanu's ..... birthday is today. (11 / 5)

3. Write the place value and number.

1. Place value of 5 in 5216 = ... (5000 / 50)

2. Place value of 7 in 875 = ... (70 / 700)

3. Face value of 2 in 4235 = ... (2 / 200)

4. 3000 + 500 + 20 + 4 = ... (3524 / 3254)

5. 6000 + 50 + 8 = ... (6058 / 6508)

4. Match each object with its correct price.



₹80 (Bucket)



₹40 (Lock)

5. Solve as directed and fill in the blanks.

1. Roman numeral for 5 = ... (V / X)

2. Roman numeral for 10 = ... (X / L)

3. Roman numeral for 50 = ... (L / C)

4. Roman numeral for 100 = ... (C / D)

5. Write three hundred sixty-five in figures: ..... (365 / 356)

6. The number just before 8901 is ..... (8900 / 8902)

6. Complete the picture of the remaining half (1/2).

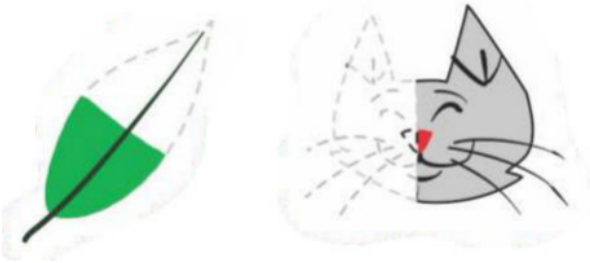

7. Choose the correct option and tick (✓).

A 3-digit greatest number: ☐ 999 ☐ 100

A 4-digit smallest number: ☐ 1000 ☐ 9999

Value of 4 in 5470: ☐ 400 ☐ 40

999 + 1 equals: ☐ 1000 ☐ 998

8. Look at the picture and tick (✓) the correct answer.

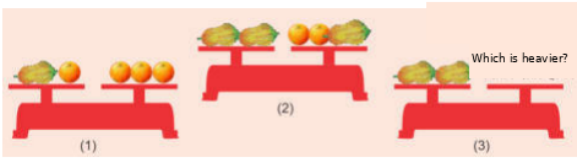

☐ There are 4 oranges ☐ There are 2 oranges

9. Write the numbers in words or in figures.

(i) Write 4312 in words:

.....

(ii) Write 5605 in words:

.....

(iii) Write 'Five thousand fifty-six' in figures:

.....

(iv) Write 'Nine thousand seven hundred ten' in figures:

.....

10. Colour the shapes according to the fractions.

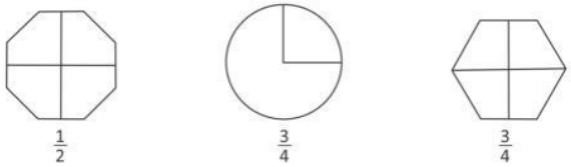

11. Identify the number pattern and continue it.

(i) 2000, 2100, 2200, 2300, ...

.....

(ii) 9876, 9875, 9874, 9873, ...

.....

(iii) 4734, 4834, 4934, 5034, ...

.....

(iv) 6625, 6626, 6627, 6628, ...

.....

12. Solve the textbook questions.

(i) Find the total of ₹2355 and ₹4675.

.....

(ii) A farmer has 578 mangoes and 324 mangoes. How many mangoes are there in all?

.....

(iii) There are 432 boys and 389 girls. How many students are there altogether?

.....

(iv) How much remains when ₹2986 is subtracted from ₹9887?

.....

Teacher's Remarks: .....

Signature: .....